# CFG Palier 3 Module 4 Géométrie

## Exercices cours 2 : Angles - Correction

### Correction 1.

Mesurer les angles ci-dessous :

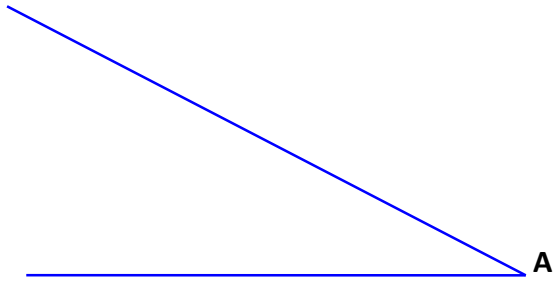


L'angle $\hat{A}$ mesure : 27°

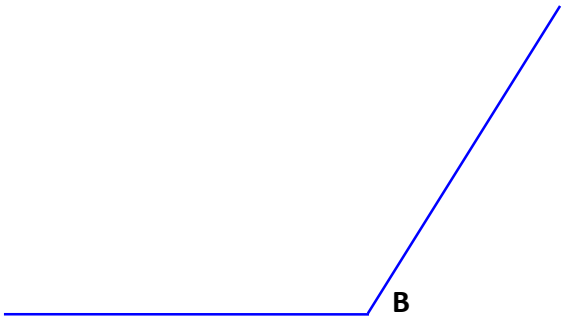


L'angle $\hat{B}$ mesure : 123°

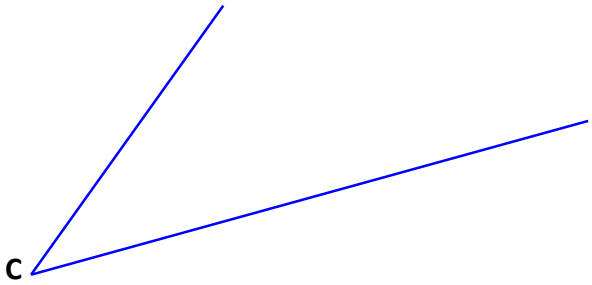


L'angle $\hat{C}$ mesure : 40°

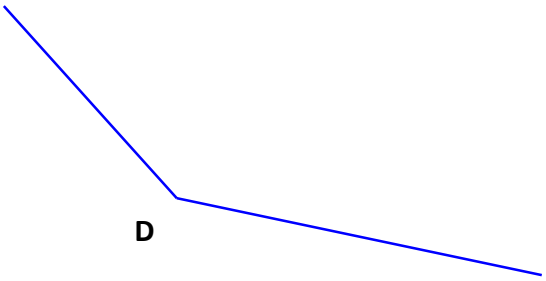


L'angle $\widehat{D}$ mesure : 143°

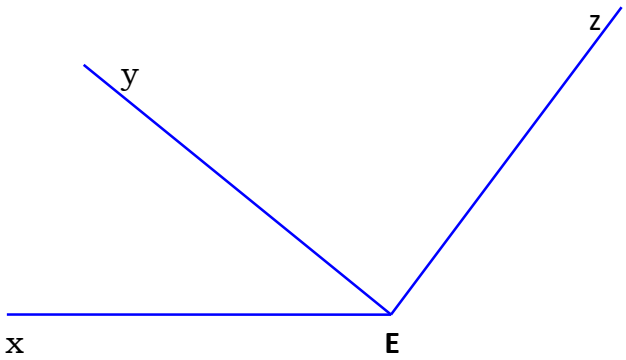


L'angle $\widehat{xEy}$ mesure : 40°

L'angle $\widehat{yEz}$ mesure : 88°




L'angle $\hat{F}$ mesure : 90°

 Copyleft 1992–2021 

Correction 2.

Tracer les angles dont les mesures sont données ci-dessous :

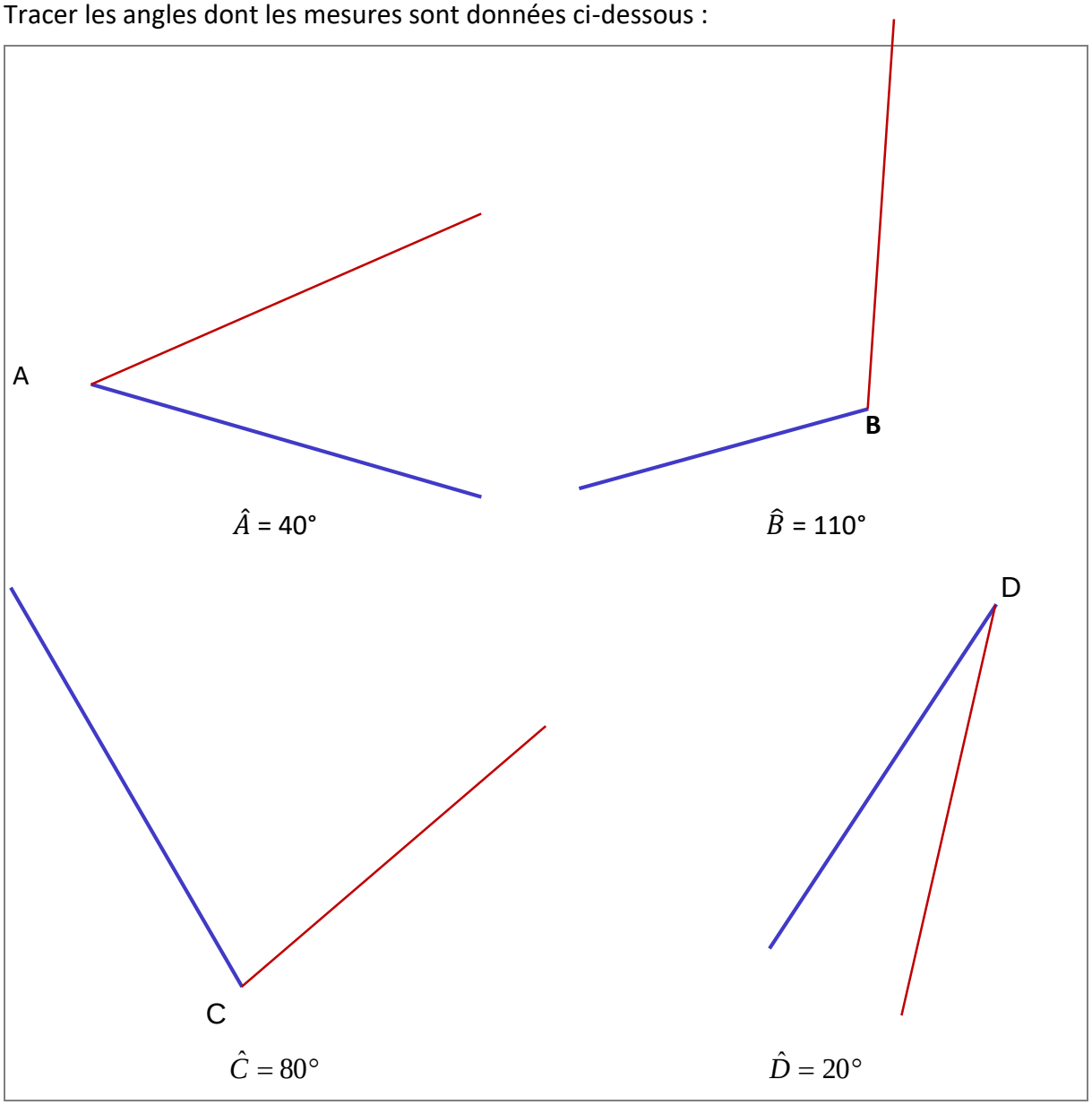

## Correction 3.

Nommer tous les angles de la figure ci-dessous et donner leur nature.

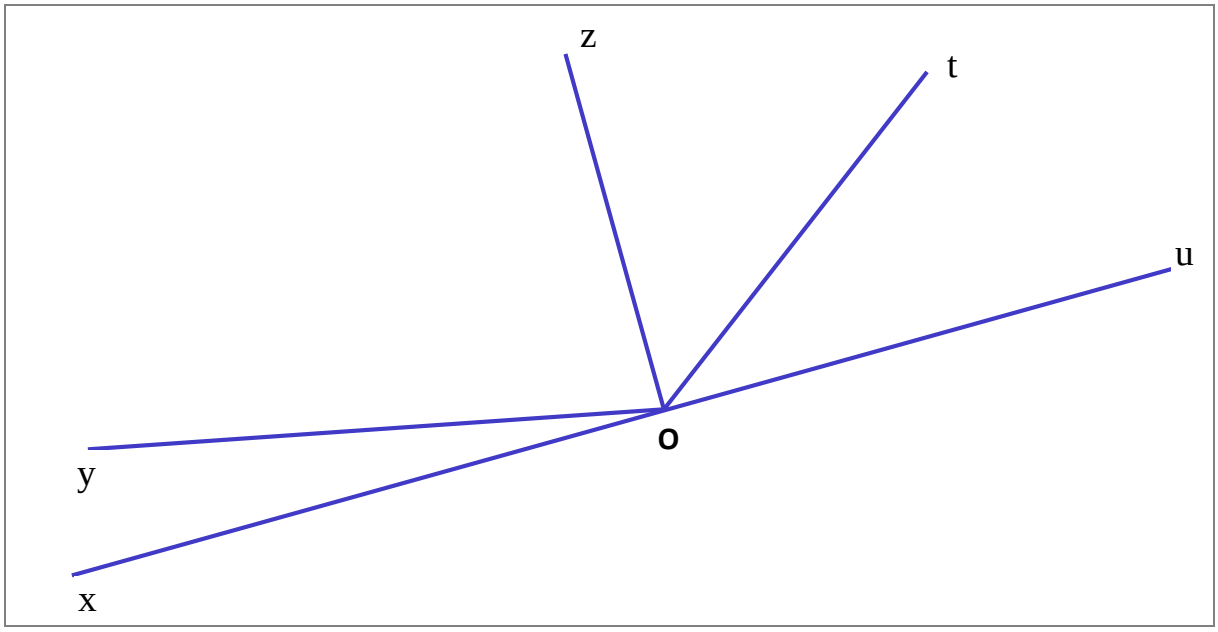


- $\widehat{xOy}$ : angle aigu ;
- $\widehat{yOz}$ : angle aigu ;
- $\widehat{zOt}$ : angle aigu ;
- $\widehat{tOu}$ : angle aigu ;
- $\widehat{uOx}$ : angle plat ;

$\widehat{xOz}$ : angle droit ;

$\widehat{yOt}$ : angle obtus ;

$\widehat{zOu}$ : angle droit ;

$\widehat{xOt}$ : angle obtus ;

$\widehat{yOu}$ : angle obtus ;

## Correction 4.

Cocher la bonne réponse.
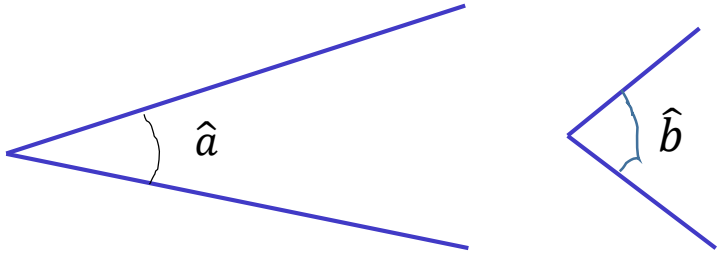
Quel est l'angle le plus grand ? L'angle $\hat{a}$ ☐ ou l'angle $\hat{b}$ ☒